1. Finden Sie die Formeln für folgende Stoffe heraus:
   EtOH, Glycerol, Ethylenglycol, MeOH, Phenol, Cyclohexanol, BuOH, Triethylamin,

   Morpholin, Piperidin, Cadaverin, Allylalkohol, Epichlorhydrin, Dibenzylsulfid, Thiophenol, Isopropanol
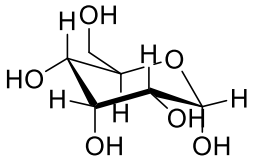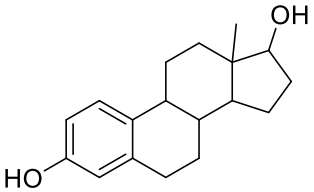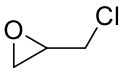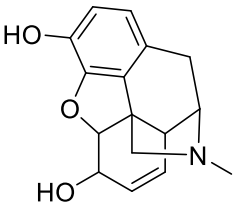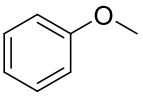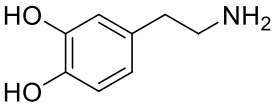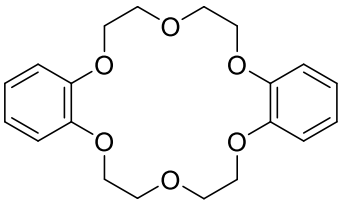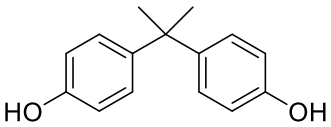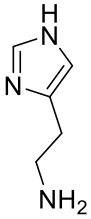
2. Ordnen Sie folgende Namen den entsprechenden Formeln zu
   Estradiol, Morphin, Glucose, Histidin, Anisol, Bisphenol-A, Dibenzo-18-Krone-6, Dopamin, Epichlorhydrin